Cambridge International AS & A Level

Cambridge International Examinations
Cambridge International Advanced Subsidiary and Advanced Level

CANDIDATE NAME

CENTRE NUMBER | | | | | |

CANDIDATE NUMBER | | | | |

1488493433

PHYSICS **9702/21**

Paper 2 AS Level Structured Questions **May/June 2018**

1 hour 15 minutes

Candidates answer on the Question Paper.

No Additional Materials are required.

READ THESE INSTRUCTIONS FIRST

Write your Centre number, candidate number and name on all the work you hand in.
Write in dark blue or black pen.
You may use an HB pencil for any diagrams or graphs.
Do not use staples, paper clips, glue or correction fluid.
DO **NOT** WRITE IN ANY BARCODES.

Answer **all** questions.

Electronic calculators may be used.
You may lose marks if you do not show your working or if you do not use appropriate units.

At the end of the examination, fasten all your work securely together.
The number of marks is given in brackets [ ] at the end of each question or part question.

This document consists of **16** printed pages and **4** blank pages.

DC (LEG/CGW) 143986/2
© UCLES 2018

CAMBRIDGE International Examinations

Data

speed of light in free space	$c = 3.00 \times 10^{8}\,\text{m s}^{-1}$
permeability of free space	$\mu_0 = 4\pi \times 10^{-7}\,\text{H m}^{-1}$
permittivity of free space	$\varepsilon_0 = 8.85 \times 10^{-12}\,\text{F m}^{-1}$
	$(\frac{1}{4\pi\varepsilon_0} = 8.99 \times 10^{9}\,\text{m F}^{-1})$
elementary charge	$e = 1.60 \times 10^{-19}\,\text{C}$
the Planck constant	$h = 6.63 \times 10^{-34}\,\text{J s}$
unified atomic mass unit	$1\,\text{u} = 1.66 \times 10^{-27}\,\text{kg}$
rest mass of electron	$m_e = 9.11 \times 10^{-31}\,\text{kg}$
rest mass of proton	$m_p = 1.67 \times 10^{-27}\,\text{kg}$
molar gas constant	$R = 8.31\,\text{J K}^{-1}\,\text{mol}^{-1}$
the Avogadro constant	$N_A = 6.02 \times 10^{23}\,\text{mol}^{-1}$
the Boltzmann constant	$k = 1.38 \times 10^{-23}\,\text{J K}^{-1}$
gravitational constant	$G = 6.67 \times 10^{-11}\,\text{N m}^2\,\text{kg}^{-2}$
acceleration of free fall	$g = 9.81\,\text{m s}^{-2}$

© UCLES 2018

Formulae

uniformly accelerated motion	$s = ut + \frac{1}{2}at^2$ $v^2 = u^2 + 2as$
work done on/by a gas	$W = p\Delta V$
gravitational potential	$\phi = -\frac{Gm}{r}$
hydrostatic pressure	$p = \rho gh$
pressure of an ideal gas	$p = \frac{1}{3}\frac{Nm}{V}\langle c^2 \rangle$
simple harmonic motion	$a = -\omega^2 x$
velocity of particle in s.h.m.	$v = v_0 \cos \omega t$ $v = \pm \omega\sqrt{(x_0^2 - x^2)}$
Doppler effect	$f_o = \frac{f_s v}{v \pm v_s}$
electric potential	$V = \frac{Q}{4\pi\varepsilon_0 r}$
capacitors in series	$1/C = 1/C_1 + 1/C_2 + \ldots$
capacitors in parallel	$C = C_1 + C_2 + \ldots$
energy of charged capacitor	$W = \frac{1}{2}QV$
electric current	$I = Anvq$
resistors in series	$R = R_1 + R_2 + \ldots$
resistors in parallel	$1/R = 1/R_1 + 1/R_2 + \ldots$
Hall voltage	$V_H = \frac{BI}{ntq}$
alternating current/voltage	$x = x_0 \sin \omega t$
radioactive decay	$x = x_0 \exp(-\lambda t)$
decay constant	$\lambda = \frac{0.693}{t_{\frac{1}{2}}}$

© UCLES 2018

[Turn over

Answer **all** the questions in the spaces provided.

1 **(a)** State what is meant by a *scalar* quantity and by a *vector* quantity.

scalar: .....

.....

vector: .....

.....

[2]

(b) Complete Fig. 1.1 to indicate whether each of the quantities is a vector or a scalar.

quantity	vector or scalar
power	
temperature	
momentum	

Fig. 1.1

[2]

(c) An aircraft is travelling in wind. Fig. 1.2 shows the velocities for the aircraft in still air and for the wind.

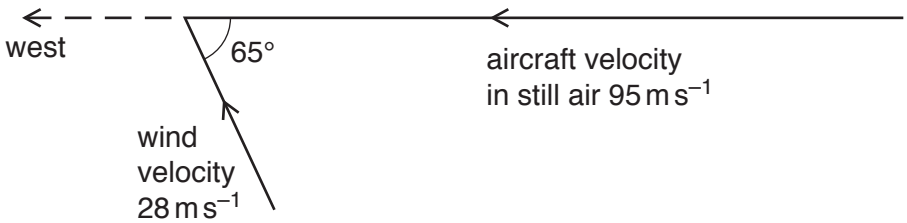

Fig. 1.2

The velocity of the aircraft in still air is 95 m s^{-1} to the west.
The velocity of the wind is 28 m s^{-1} from 65° south of east.

(i) On Fig. 1.2, draw an arrow, labelled R, in the direction of the resultant velocity of the aircraft. [1]

© UCLES 2018

(ii) Determine the magnitude of the resultant velocity of the aircraft.

magnitude of velocity = ... $m\,s^{-1}$ [2]

[Total: 7]

2 **(a)** State Newton's first law of motion.

.....

.....[1]

(b) A block of weight 15 N hangs by a wire from a remotely controlled aircraft, as shown in Fig. 2.1.

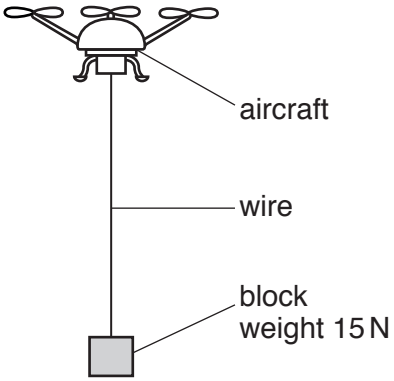

Fig. 2.1

The aircraft is used to move the block only in a vertical direction. The force on the block due to air resistance is negligible.

The variation with time t of the vertical velocity v of the block is shown in Fig. 2.2.
The velocity is taken to be positive in the upward direction.

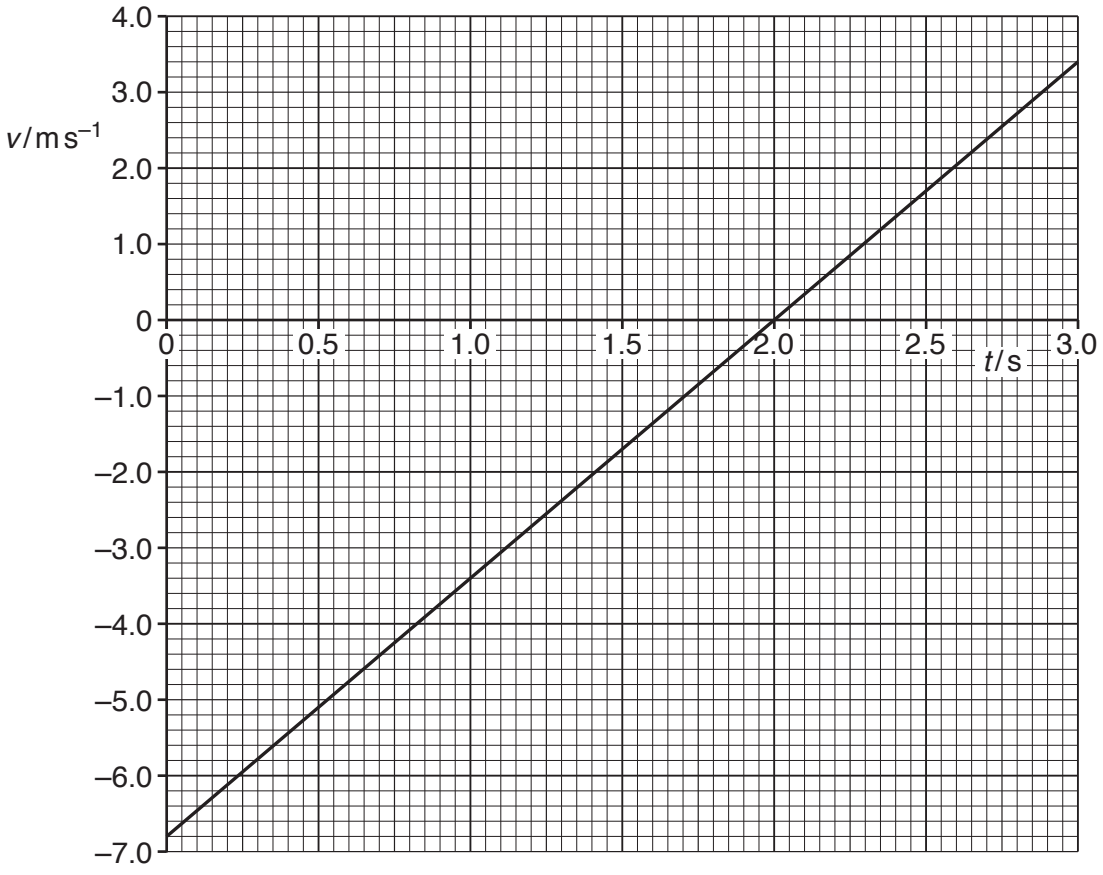

Fig. 2.2

© UCLES 2018

(i) Determine, for the block,

1. the displacement from time $t = 0$ to $t = 3.0\,\text{s}$,

magnitude of displacement = ... m

direction of displacement .....

[3]

2. the change in gravitational potential energy from time $t = 0$ to $t = 3.0\,\text{s}$.

change in gravitational potential energy = ... J [2]

(ii) Calculate the magnitude of the acceleration of the block at time $t = 2.0\,\text{s}$.

acceleration = ... m s^{-2} [2]

(iii) Use your answer in **(b)(ii)** to show that the tension T in the wire at time $t = 2.0\,\text{s}$ is 20 N.

[2]

© UCLES 2018

(iv) The wire has a cross-sectional area of $2.8 \times 10^{-5}\,m^2$ and is made from metal of Young modulus $1.7 \times 10^{11}\,Pa$. The wire obeys Hooke's law.

Calculate the strain of the wire at time $t = 2.0\,s$.

strain = ... [3]

(v) At some time after $t = 3.0\,s$ the tension in the wire has a constant value of 15 N.

State and explain whether it is possible to deduce that the block is moving vertically after $t = 3.0\,s$.

.....

.....

.....

.....[2]

[Total: 15]

© UCLES 2018

BLANK PAGE

© UCLES 2018

[Turn over

3 **(a)** State what is meant by the *mass* of a body.

.....

.....[1]

(b) Two blocks travel directly towards each other along a horizontal, frictionless surface. The blocks collide, as illustrated in Fig. 3.1.

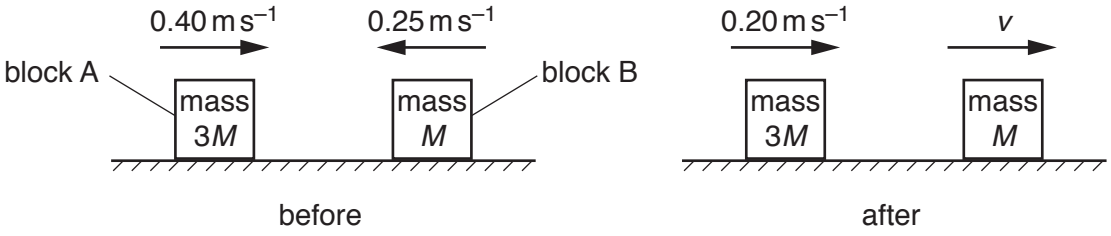

Fig. 3.1

Block A has mass 3*M* and block B has mass *M.*
Before the collision, block A moves to the right with speed 0.40 m s^{-1} and block B moves to the left with speed 0.25 m s^{-1}.
After the collision, block A moves to the right with speed 0.20 m s^{-1} and block B moves to the right with speed *v*.

(i) Use Newton's third law to explain why, during the collision, the change in momentum of block A is equal and opposite to the change in momentum of block B.

.....

.....

.....

.....[2]

(ii) Determine speed *v*.

v = ... m s^{-1} [3]

© UCLES 2018

(iii) Calculate, for the blocks,

1. the relative speed of approach,

relative speed of approach = ... $m\,s^{-1}$

2. the relative speed of separation.

relative speed of separation = ... $m\,s^{-1}$
[2]

(iv) Use your answers in **(b)(iii)** to state and explain whether the collision is elastic or inelastic.

.....

.....[1]

[Total: 9]

© UCLES 2018

[Turn over

4 **(a)** For a progressive wave, state what is meant by

(i) the *period*,

.....

.....[1]

(ii) the *wavelength*.

.....

.....[1]

(b) Fig. 4.1 shows the variation with time t of the displacement x of two progressive waves P and Q passing the same point.

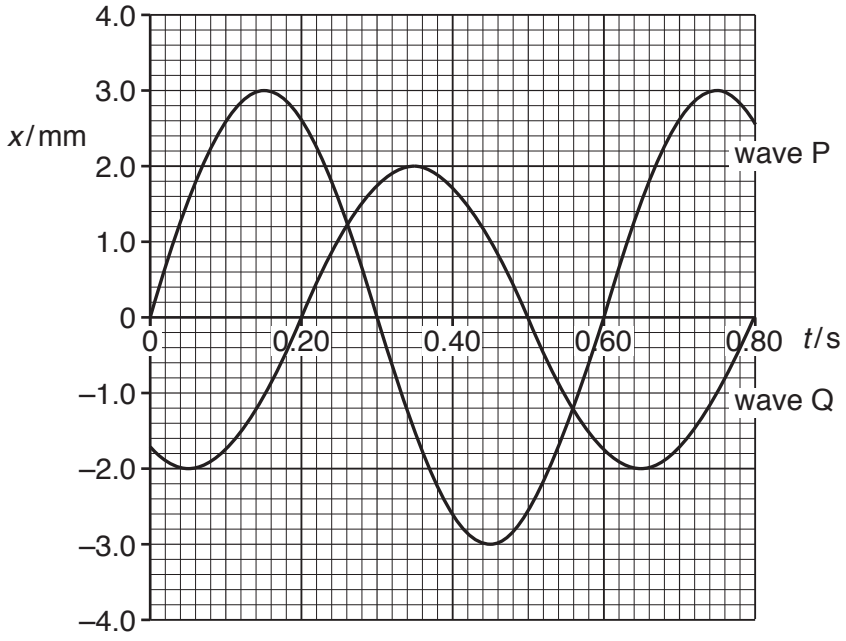

Fig. 4.1

The speed of the waves is 20 cm s^{-1}.

(i) Calculate the wavelength of the waves.

wavelength = ... cm [2]

© UCLES 2018

(ii) Determine the phase difference between the two waves.

phase difference = ... ° [1]

(iii) Calculate the ratio

$$\frac{\text{intensity of wave Q}}{\text{intensity of wave P}}.$$

ratio = ... [2]

(iv) The two waves superpose as they pass the same point. Use Fig. 4.1 to determine the resultant displacement at time $t = 0.45\,\text{s}$.

displacement = ... mm [1]

[Total: 8]

BLANK PAGE

© UCLES 2018

5 **(a)** When monochromatic light is incident normally on a diffraction grating, the emergent light waves have been diffracted and are coherent.

Explain what is meant by

(i) *diffracted* waves,

.....

.....[1]

(ii) *coherent* waves.

.....

.....[1]

(b) Light consisting of only two wavelengths λ_1 and λ_2 is incident normally on a diffraction grating.

The third order diffraction maximum of the light of wavelength λ_1 and the fourth order diffraction maximum of the light of wavelength λ_2 are at the same angle θ to the direction of the incident light.

(i) Show that the ratio $\frac{\lambda_2}{\lambda_1}$ is 0.75.

Explain your working.

[2]

(ii) The difference between the two wavelengths is 170 nm.

Determine wavelength λ_1.

λ_1 = ... nm [1]

[Total: 5]

6 **(a)** Define the *volt*.

.....[1]

(b) A battery of electromotive force (e.m.f.) 4.5 V and negligible internal resistance is connected to two filament lamps P and Q and a resistor R, as shown in Fig. 6.1.

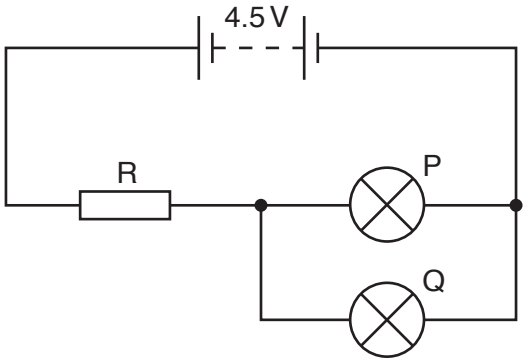

Fig. 6.1

The current in lamp P is 0.15 A.
The I–V characteristics of the filament lamps are shown in Fig. 6.2.

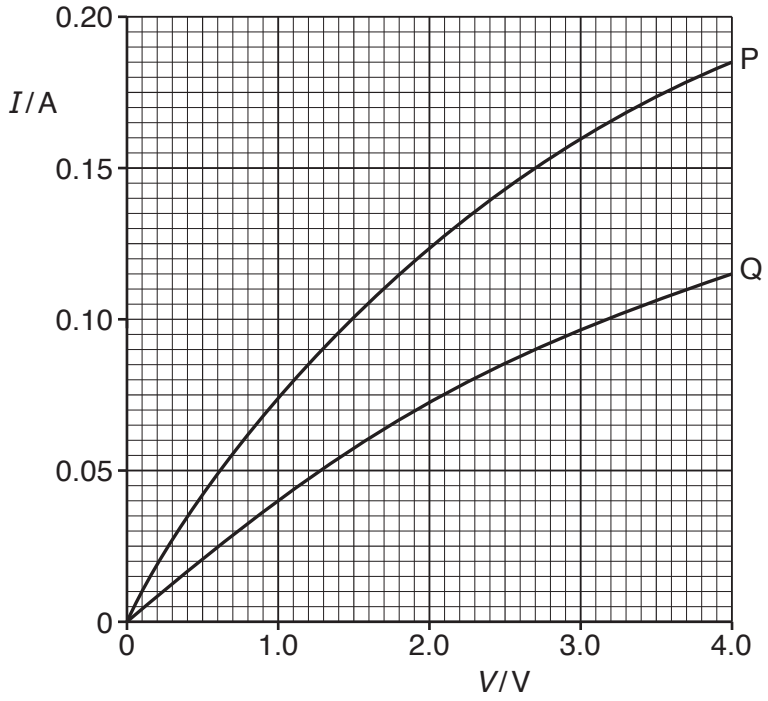

Fig. 6.2

(i) Use Fig. 6.2 to determine the current in the battery. Explain your working.

current = ... A [2]

© UCLES 2018

(ii) Calculate the resistance of resistor R.

resistance = ... Ω [2]

(iii) The filament wires of the two lamps are made from material with the same resistivity at their operating temperature in the circuit. The diameter of the wire of lamp P is twice the diameter of the wire of lamp Q.

Determine the ratio

$$\frac{\text{length of filament wire of lamp P}}{\text{length of filament wire of lamp Q}}.$$

ratio = ... [3]

(iv) The filament wire of lamp Q breaks and stops conducting.

State and explain, qualitatively, the effect on the resistance of lamp P.

.....

.....

.....

.....[2]

[Total: 10]

7 A β^- particle from a radioactive source is travelling in a vacuum with kinetic energy 460 eV. The particle enters a uniform electric field at a right-angle and follows the path shown in Fig. 7.1.

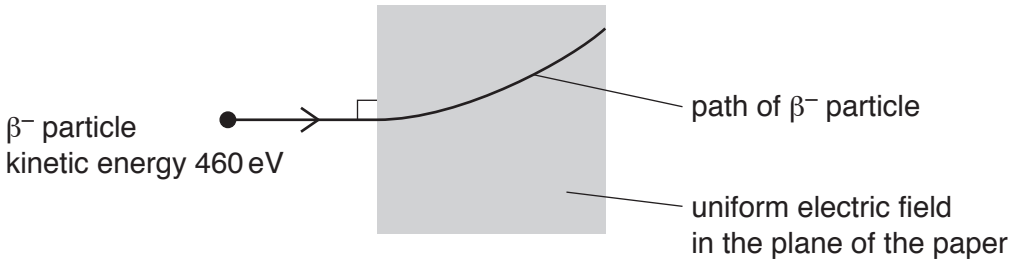

Fig. 7.1

(a) The direction of the electric field is in the plane of the paper.
On Fig. 7.1, draw an arrow to show the direction of the electric field. [1]

(b) Calculate the speed of the β^- particle before it enters the electric field.

speed = ... $m\,s^{-1}$ [3]

(c) Other β^- particles from the same radioactive source travel outside the electric field along the same incident path as that shown in Fig. 7.1.

State and briefly explain whether those β^- particles will all follow the same path inside the electric field.

.....

.....

.....

.....[2]

[Total: 6]

© UCLES 2018

BLANK PAGE

© UCLES 2018

BLANK PAGE

Permission to reproduce items where third-party owned material protected by copyright is included has been sought and cleared where possible. Every reasonable effort has been made by the publisher (UCLES) to trace copyright holders, but if any items requiring clearance have unwittingly been included, the publisher will be pleased to make amends at the earliest possible opportunity.

To avoid the issue of disclosure of answer-related information to candidates, all copyright acknowledgements are reproduced online in the Cambridge International Examinations Copyright Acknowledgements Booklet. This is produced for each series of examinations and is freely available to download at www.cie.org.uk after the live examination series.

Cambridge International Examinations is part of the Cambridge Assessment Group. Cambridge Assessment is the brand name of University of Cambridge Local Examinations Syndicate (UCLES), which is itself a department of the University of Cambridge.

© UCLES 2018